Angoli e cambi di direzione

Per andare alla funivia Bassotto quante volte cambia direzione?

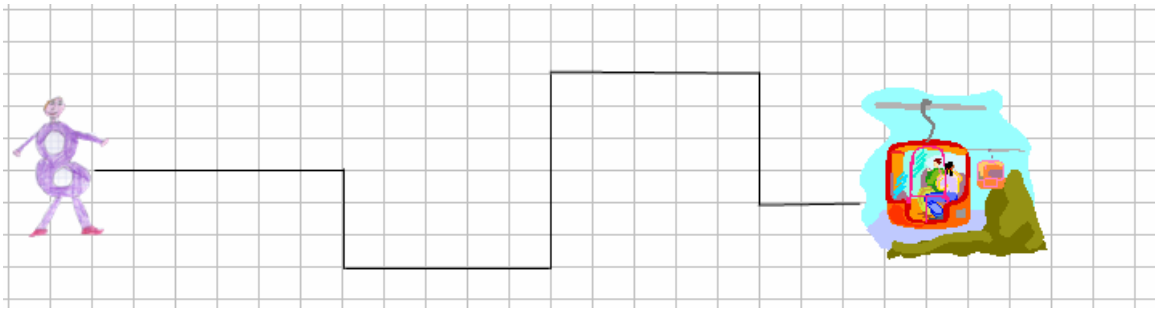

Ora disegna tu il percorso di Bassotto, facendogli cambiare direzione 5 volte



Indica con una pallina ogni cambio di direzione e scrivi sotto ad ogni figura quanti sono i cambi di direzione

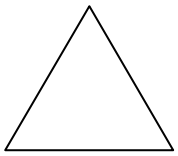

……..

……..

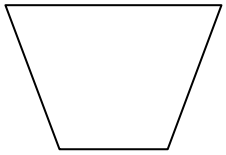

……..

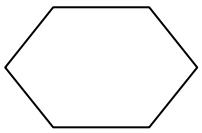

……..



……..

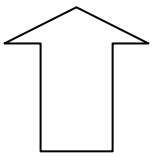

……..