Osserva le figure e colora i quadratini corrispondenti alle risposte esatte.

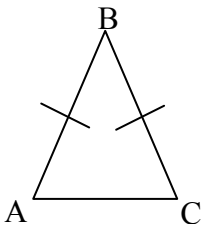

Il triangolo ABC è:
- ❑ equilatero
- ❑ equiangolo
- ❑ un poligono regolare

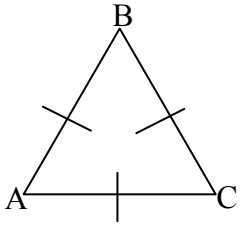

Il triangolo ABC è:
- ❑ equilatero
- ❑ equiangolo
- ❑ un poligono regolare

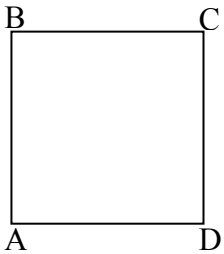

Il quadrato ABCD è:
- ❑ equilatero
- ❑ equiangolo
- ❑ un poligono regolare



Il rettangolo ABCD è:
- ❑ equilatero
- ❑ equiangolo
- ❑ un poligono regolare

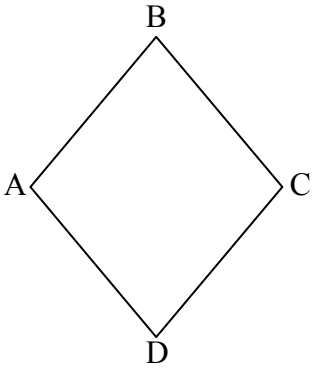

Il rombo ABCD è:
- ❑ equilatero
- ❑ equiangolo
- ❑ un poligono regolare

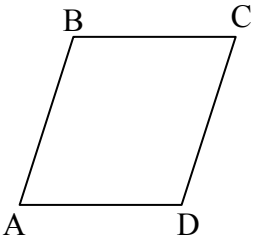

Il romboide ABCD è:
- ❑ equilatero
- ❑ equiangolo
- ❑ un poligono regolare

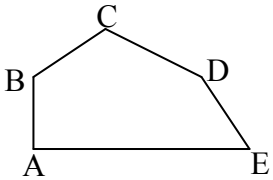

Il pentagono ABCDE è:
- ❑ equilatero
- ❑ equiangolo
- ❑ un poligono regolare

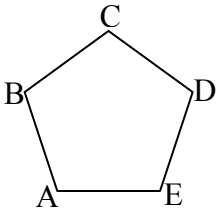

Il pentagono ABCDE è:
- ❑ equilatero
- ❑ equiangolo
- ❑ un poligono regolare