Peso lordo, peso netto, tara

- **Scrivi sotto alla figura corrispondente: peso lordo, peso netto, tara**





…… …… ……

- **Calcola i pesi mancanti e trascrivi completando le tabelle**





…… 3 kg 2,5 kg kg

Peso lordo	Peso netto	Tara
……..	……..	……..

…… 2 kg 8 kg

Peso lordo	Peso netto	Tara
……..	……..	……..