CLASSE 5 NOME ……..COGNOME ……

Verifica di matematica: il perimetro

1. Calcola il perimetro di ogni triangolo *(punti previsti 6 – punti assegnati ……..)*

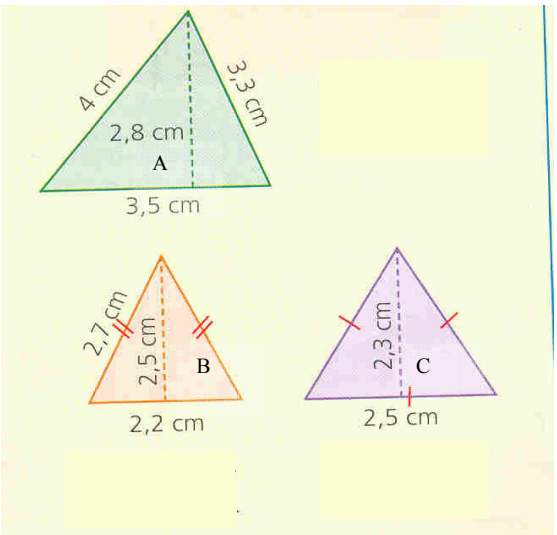

A =

B =

C =

2. Calcola il perimetro *(punti previsti 14 – punti assegnati ……..)*

 3,5 cm	p = …… …….. ……..
 3 dm 3,4 dm	p = …… …….. ……..
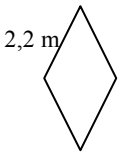 2,2 m	p = …… …….. ……..
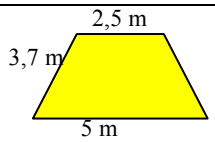 2,5 m 3,7 m 5 m	p = …… …….. ……..

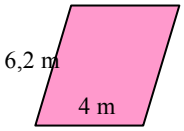 6,2 m 4 m	p = …… …….. ……..
5 dm	p = …… …….. ……..
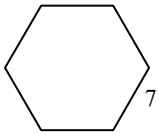 7 cm	p = …… …….. ……..

OBIETTIVI DELLA VERIFICA

- Saper calcolare il perimetro delle principali figure piane

PUNTI: …….. su 20 **VOTO: ……**

VOTO MEDIO DELLA CLASSE: ……

FIRMA INSEGNANTE: ……FIRMA GENITORE: ……..

Punteggio e voti:
minore o uguale a 11 = **5**
12 p = **6**
da 13 a 14 p = **7**
da 15 a 16 p = **8**
da 17 a 19 = **9**
20 p = **10**

TABULAZIONE VERIFICA

N° prove	1	2	**Totale**	**VOTO**
Punti	**6**	**14**	**20**	
ALUNNI				